Thank you for downloading!

THE FOLLOWING FREE PRINTABLE WAS CREATED BY ERICA FROM THE SIMPLIFIED CLASSROOM FOR THE STEM LABORATORY.

COPYING ANY PART OF THIS PRODUCT AND PLACING IT ON THE INTERNET IS STRICTLY FORBIDDEN AND IS A VIOLATION OF THE DIGITAL MILLENNIUM COPYRIGHT ACT. THANK YOU FOR RESPECTING MY WORK!

the Simplified Classroom

© THE SIMPLIFIED CLASSROOM FOR THE STEM LABORATORY

Credit for Graphics and Fonts:

CREATIVE Clips KRISTA WALLDEN

kimberly geswein fonts kg

ALL FONTS hello fonts by Jen Jones COMMERCIAL USE LICENSE

ZIP-A-DEE DOO-DAH Designs

Cactus Themed
Math Skills – Practice Cards

Math Skills Practice Cards

Skip count by 10s from 30 to 80.

©The Simplified Classroom for The STEM Laboratory

Start at 86 and count up to 115.

©The Simplified Classroom for The STEM Laboratory

Add 100 + 50

By: The Simplified Classroom for The STEM Laboratory

Recommended: Print pages onto cardstock, laminate them, then cut apart the practice cards! ☺

If you have a nickel and 5 pennies, how much money do you have?



What time is it?

©The Simplified Classroom for The STEM Laboratory

Skip count by 2s from 2 to 24.

©The Simplified Classroom for The STEM Laboratory

What is 17 - 5 ?

By: The Simplified Classroom for The STEM Laboratory

These could be used as an extension activity for "early finishers," a partner game, or even an assessment!

Which number is even?

6 or 7



What time is it?

©The Simplified Classroom for The STEM Laboratory

Add.

$$\begin{array}{r} 12 \\ +23 \\ \hline \end{array}$$

©The Simplified Classroom for The STEM Laboratory

How many minutes are in an hour?

By: The Simplified Classroom for The STEM Laboratory

Check out www.TheSimplifiedClassroom.com and www.TheSTEMLaboratory.com for more activities!

How much is a quarter worth?

What number is missing?

6 + ___ = 10

©The Simplified Classroom for The STEM Laboratory

Subtract.

45
-32

©The Simplified Classroom for The STEM Laboratory

What fraction is shown?

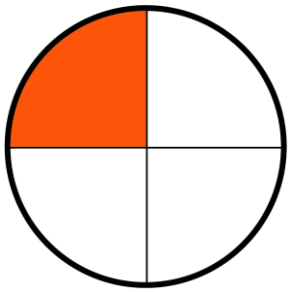

By: The Simplified Classroom for The STEM Laboratory